FAITH THINKERS
Traditional Arithmetic & Logic

Name: _____

Volume of rectangular prisms

Grade 4 Geometry Worksheet

Volume = length x width x height

4 ft

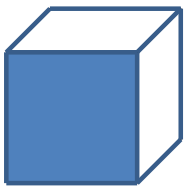

4 in

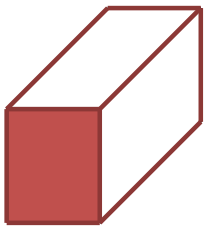

2 cm

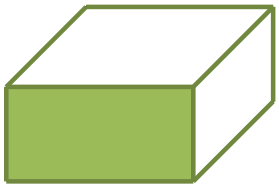

8 m

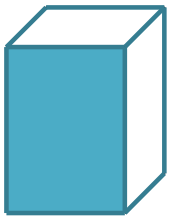

5.5 in
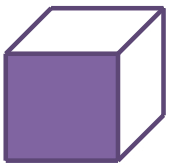
7 ft